MATHEMATIQUES - Nombres et calcul

CE1

Nom : ……

DATE :……

1

1 Ecris le nombre d'étoiles .



2 Ecris le nombre de points .

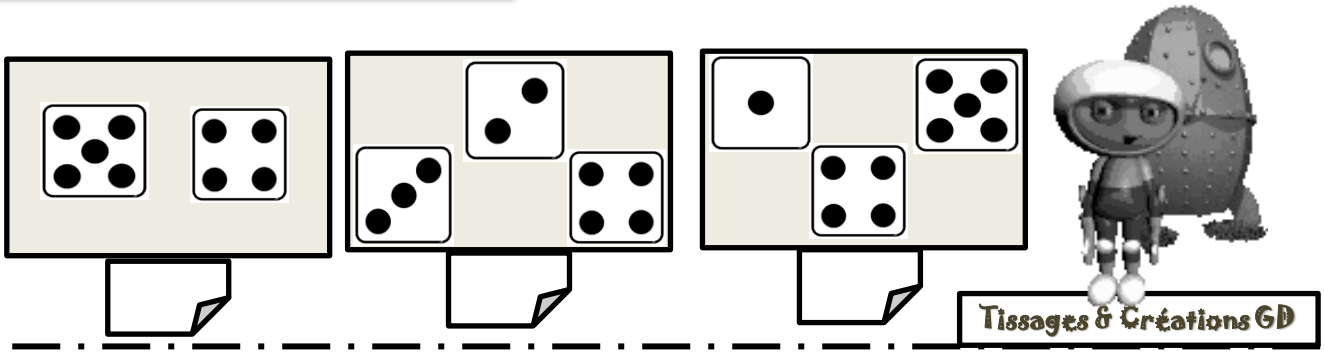

Tissages & Créations GD

MATHEMATIQUES - Nombres et calcul

CE1

Nom : ……

DATE :……

2

1 Ecris le nombre de doigts .

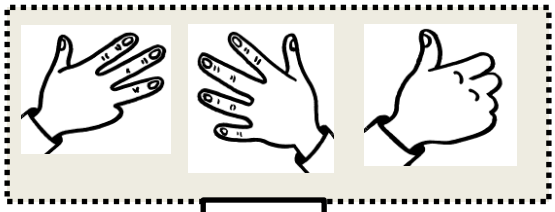

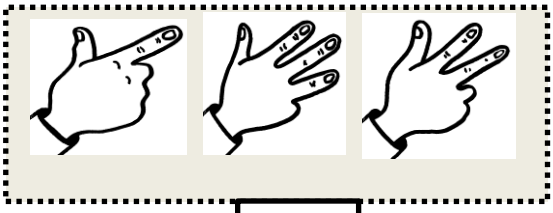

2 Observe le chemin et complète .

+1

4		6						12	

10	★		★		★		★		★

3 Trouve le nombre d'étoiles .

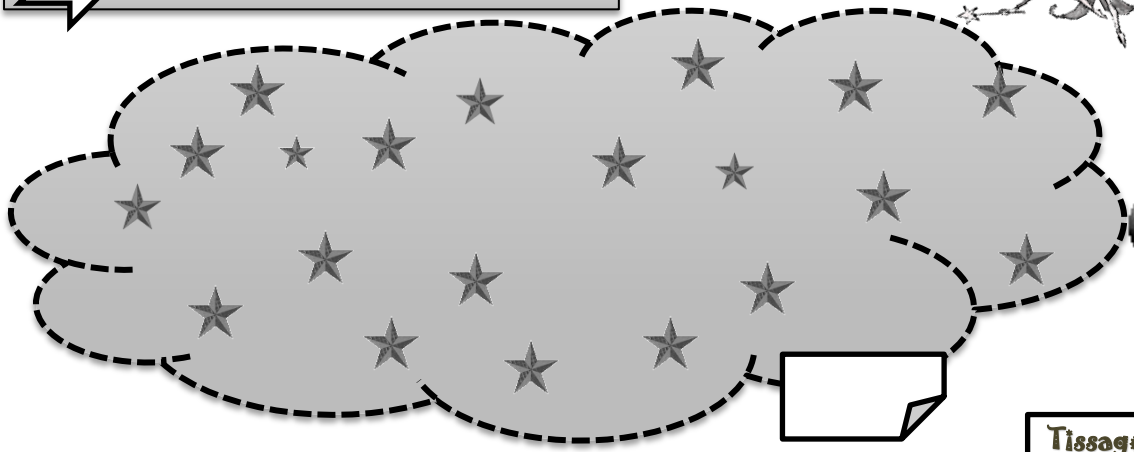

Tissages & Créations GD

MATHEMATIQUES - Nombres et calcul

CE1

Nom : ……

DATE :……

3

1 Compare avec les signes > , < ou = .



5 …… 10



11 …… 3



4 …… 4

2 Ecris un nombre .

8

12

18

3 Compare avec les signes > , < .

13 …… 6

14 …… 11

17 …… 19

4 Continue le compte à rebours puis complète la suite des robots .

-1

20																			

+2



Tissages & Créations GD

MATHEMATIQUES - Nombres et calcul

CE1

Nom : ……

DATE :……

4

CODE SECRET niveau 1

1 Range les nombres du plus petit au plus grand .

15 9 13 4 17

……

2 Colorie les cases d'arrivée

+ 7

- 5

4	5	6	7	8	9	10	11	12	13	14	15	16	17	18	19	20	21	22	23

3

6 — Ajoute 4

…… + …… = …….

3 — Ajoute 5

…… + …… = …….

9 — Ajoute 9

…… + …… = …….

10 — Ajoute 2

…… + …… = …….

7 — Ajoute 4

…… + …… = …….

Tissages & Créations GD

MATHEMATIQUES - Nombres et calcul

CE1

Nom : ……

DATE :……

5

CODE SECRET niveau 1

1 Range les nombres du plus grand au plus petit .

……



2 Colorie les cases d'arrivée .

+ 6

- 8

4	5	6	7	8	9	10	11	12	13	14	15	16	17	18	19	20	21	22	23

3



…… - …… = …….



…… - …… = …….



…… - …… = …….



…… - …… = …….



…… - …… = …….

Tissages & Créations GD

MATHEMATIQUES - Nombres et calcul

CE1

Nom : ……

DATE :……

6

CODE SECRET niveau 1

1 Complète .

7

OOOOOOO	…… + …… = …….
●OOOOOO	…… + …… = …….
●●OOOOO	…… + …… = …….
●●●OOOO	…… + …… = …….
●●●●OOO	…… + …… = …….
●●●●●OO	…… + …… = …….
●●●●●●O	…… + …… = …….
●●●●●●●	…… + …… = …….

10

	0 + 10 = 10
	1 + 9 = 10
	2 + 8 = 10
	3 + 7 = 10
	4 + 6 = 10
	5 + 5 = 10
	6 + 4 = 10
	7 + 3 = 10
	8 + 2 = 10
	9 + 1 = 10
	10 + 0 = 10

2 Barre l'intrus .



Tissages & Créations GD

MATHEMATIQUES - Nombres et calcul

CE1

Nom : ……

DATE :……

7

CODE SECRET niveau 1

1 Ecris les nombres .

4	5
2	3
0	1

2 Relie .



Vrac-coloiages.net

3 Trouve les doubles .



Tissages & Créations GD

MATHEMATIQUES - Nombres et calcul

CE1

Nom : ……

DATE :……

8

CODE SECRET niveau 1

1 Colorie .

10 jaune
11 bleu
12 rouge
13 vert
14 orange
15 gris
16 rose



www.vrac-coloriages.net

2 Trouve les moitiés .



Tissages & Créations GD

MATHEMATIQUES - Nombres et calcul

CE1

Nom : ……

DATE :……

9

1 Complète la bulle ou le sac de Starsmind .



8 + …… = **15**

11 + …… = **20**

…… + **3** = **15**

…… + **6** = **20**

2 Observe le rangement de la fée puis écris le nombre d'étoiles

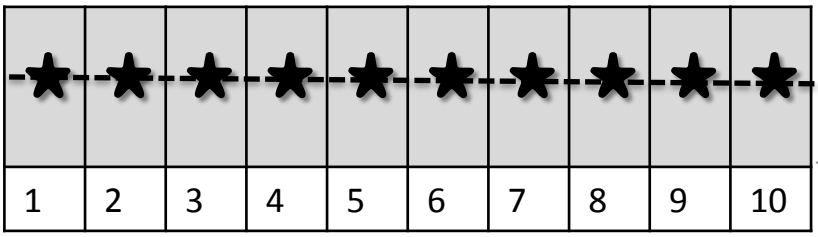

1	2	3	4	5	6	7	8	9	10

En chiffres : ……

En lettres : ……



En chiffres : ……

En lettres : ……

En chiffres : ……

En lettres : ……

Tissages & Créations GD

MATHEMATIQUES - Nombres et calcul

CE1

Nom : ……

DATE : ……

10

1 Compte puis complète les étiquettes .

……



……

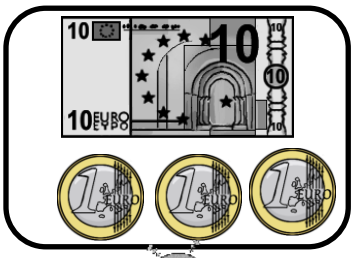

……



……

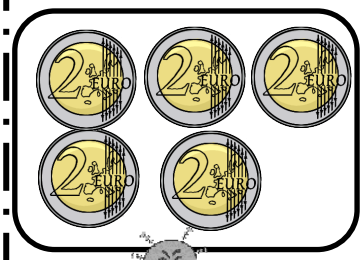

……



……

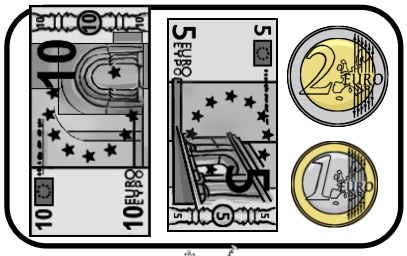

……

2 Ecris le nombre de gouttes .

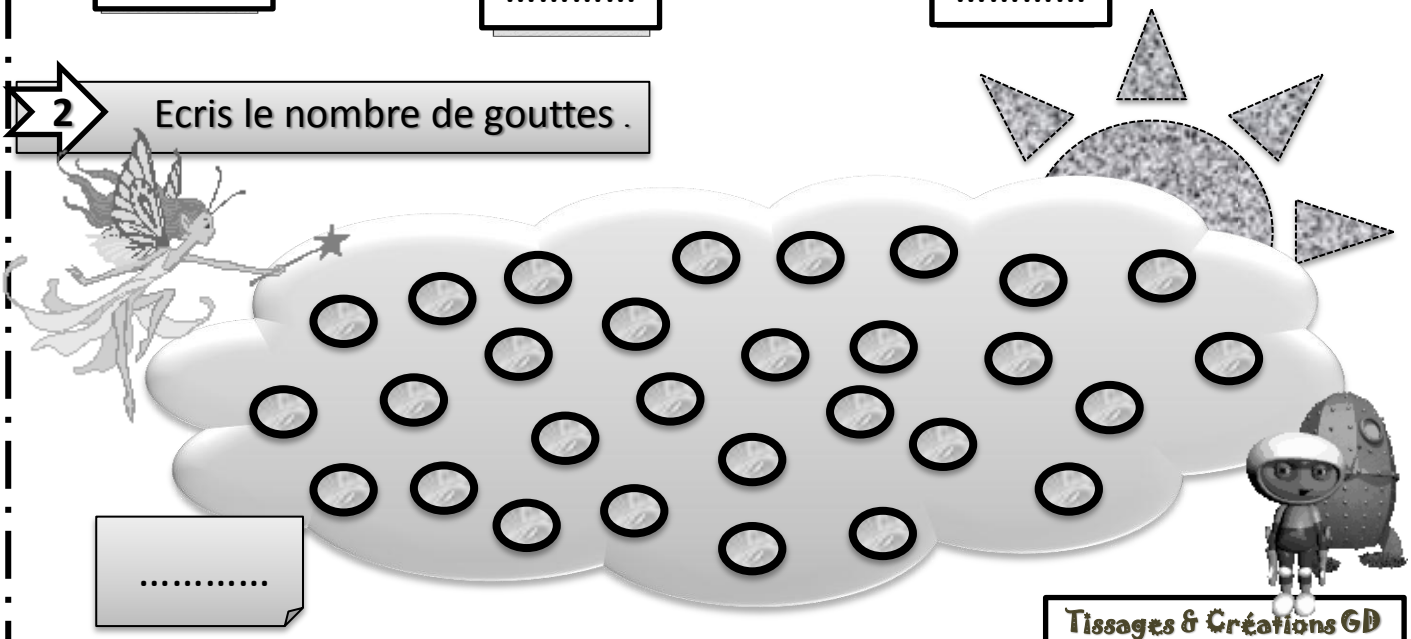

……

MATHEMATIQUES - Nombres et calcul

CE1

Nom : .....

+	0	1	2	3	4	5	6	7	8	9	10
0											
1											
2											
3											
4											
5											
6											
7											
8											
9											
10											



Tissages & Créations GD